Placing Numbers on Number Lines (H)

Name: _____ Date: _____ Score: _____

Draw a star at the place on the number line where you would find each number.

0

400

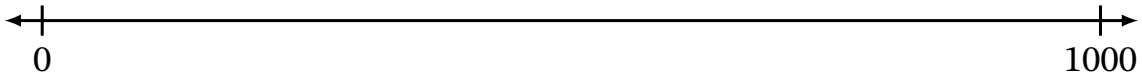

1000



800



500



200

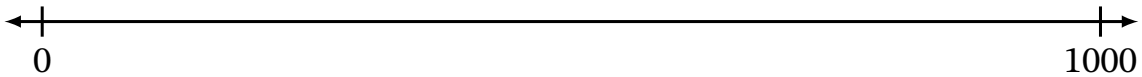

900



300



700


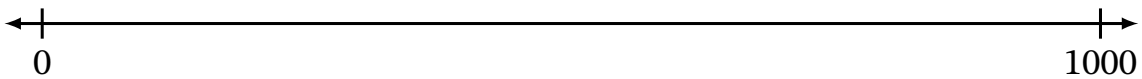
600